Date : ……

MATHEMATIQUES

•Calcule :

7+2=… 5+5=… 5+6=…

3+6=… 7+3=… 3+8=…

•Calcule :

10 - 2=… 9 - 1=… 9 - 1=…

7 - 3=… 6 - 2=… 5 - 1=…

Groupe les jetons par dix :



Dessine les groupes de 10 et les jetons isolés comme Perrine:

•Qui a le plus ? Combien de plus ? Complète (entoure la tête et écris la différence).

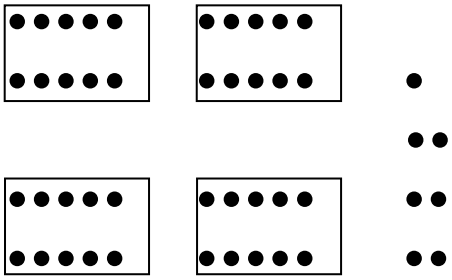

Perrine a ……. jetons



Picbille a ……. jetons



•Complète :